METER WORKSHEET

COVER THE ANSWERS BELOW.
Indicate the note value that is the beat and add barlines to each example:

BEAT_____

BEAT_____



BEAT_____



Answers:

BEAT quarter note



BEAT quarter note



BEAT dotted quarter note